Dividing with a Numberline

Name:

Use the numberline to solve each problem.

1) 18÷6=

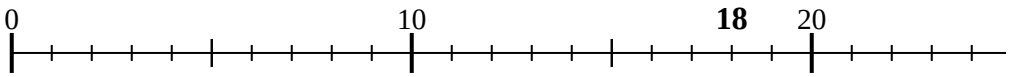

2) 36÷9=

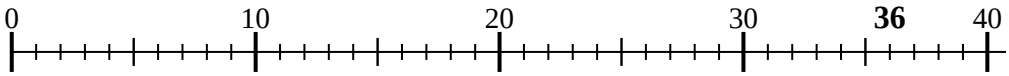

3) 14÷7=

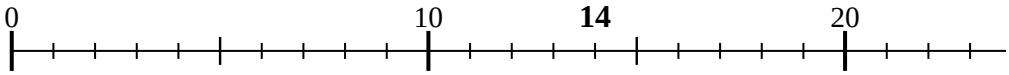

4) 16÷8=

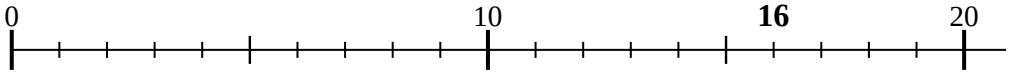

5) 32÷8=

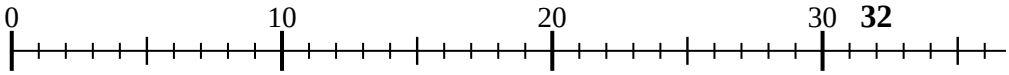

6) 15÷3=

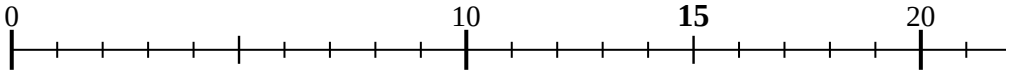

7) 24÷6=

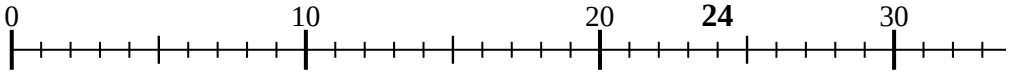

8) 25÷5=

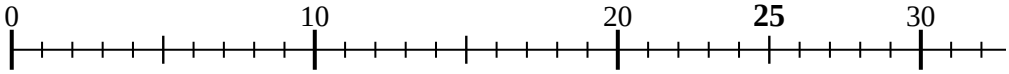

9) 28÷7=

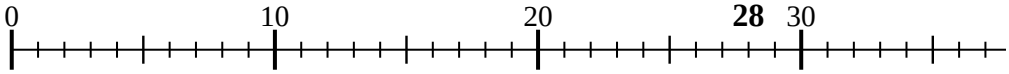

10) 40÷10=

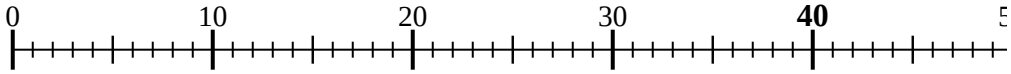

11) 27÷9=

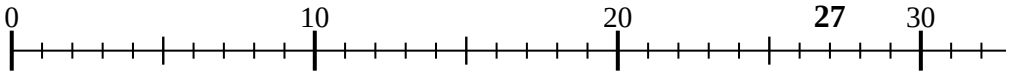

Answers

1. _____
2. _____
3. _____
4. _____
5. _____
6. _____
7. _____
8. _____
9. _____
10. _____
11. _____

1-10	91	82	73	64	55	45	36	27	18	9
11	0									

Dividing with a Numberline

Name: **Answer Key**

Use the numberline to solve each problem.

1) 18÷6=

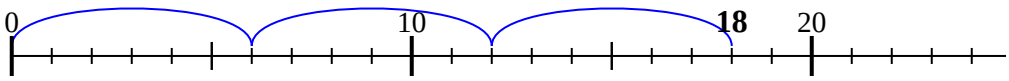

2) 36÷9=

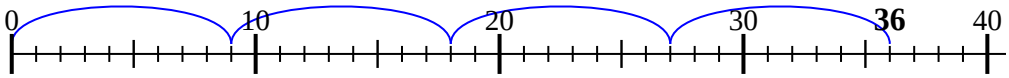

3) 14÷7=

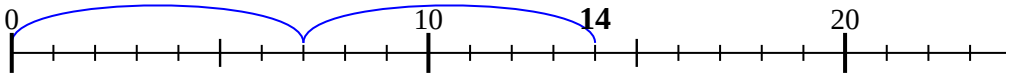

4) 16÷8=

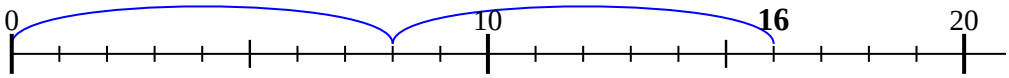

5) 32÷8=

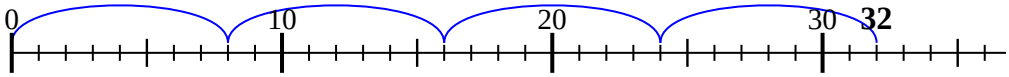

6) 15÷3=

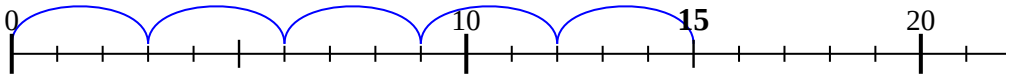

7) 24÷6=

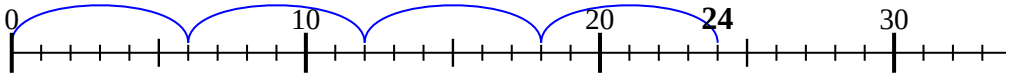

8) 25÷5=

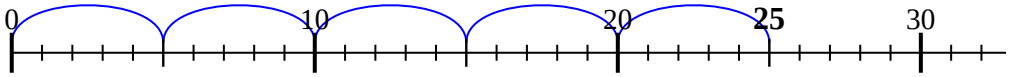

9) 28÷7=

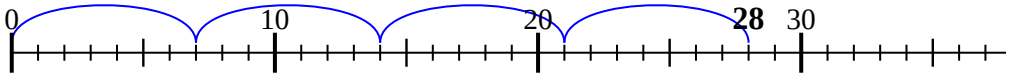

10) 40÷10=

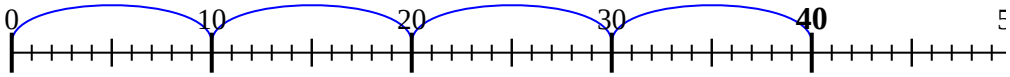

11) 27÷9=

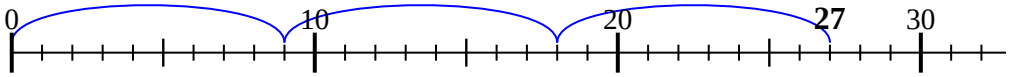

Answers

1. 3
2. 4
3. 2
4. 2
5. 4
6. 5
7. 4
8. 5
9. 4
10. 4
11. 3